Heft 10

(Ziel 10)



Plus rechnen mit Friedolin - Analogieaufgaben

Zahlenraum bis 20

Name:_____

Heft 10

(Ziel 10)



Plus rechnen mit Friedolin - Analogieaufgaben

Zahlenraum bis 20

Name:_____

www.lernmaterial.mathematikbegreifen.de

Lege und rechne am Zahlenbrett! Nutze die Hilfsaufgabe!



5 + 3 = 8

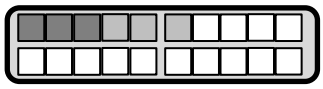



15 + 3 = 18

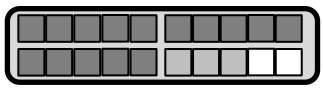

4 + 4 = ___

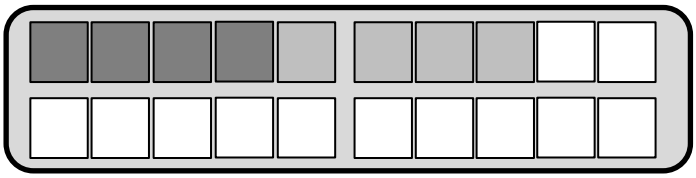

14 + 4 =___

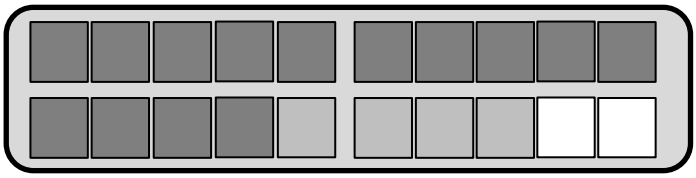

6 + 4= ___

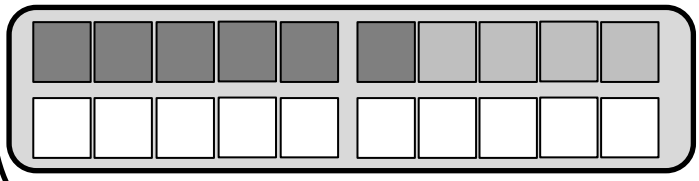

16 + 4 = ___

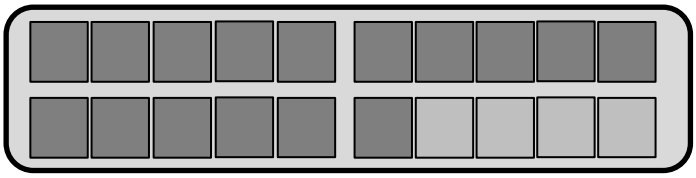

Lege und rechne am Zahlenbrett! Nutze die Hilfsaufgabe!



5 + 3 = 8

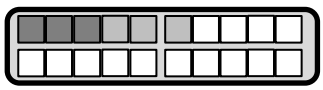



15 + 3 = 18

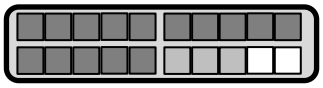

4 + 4 = ___

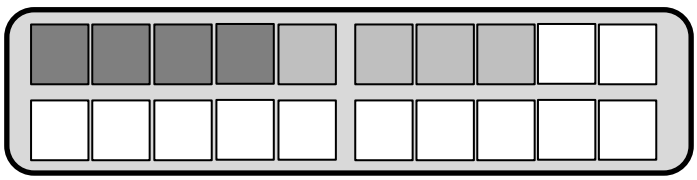

14 + 4 =___

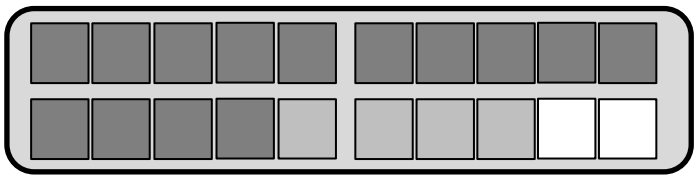

6 + 4= ___

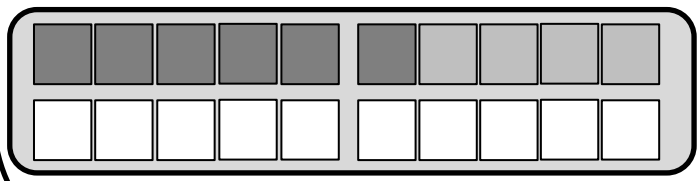

16 + 4 = ___

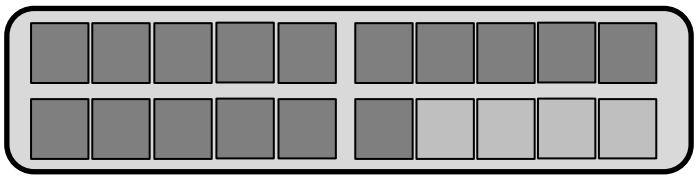

www.lernmaterial.mathematikbegreifen.de

5 + 3 = ___

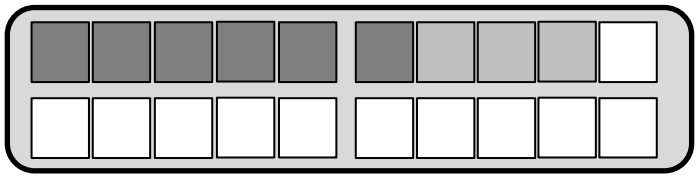

15 + 3 =___

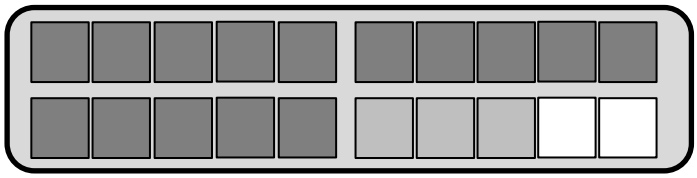

4 + 3 = ___

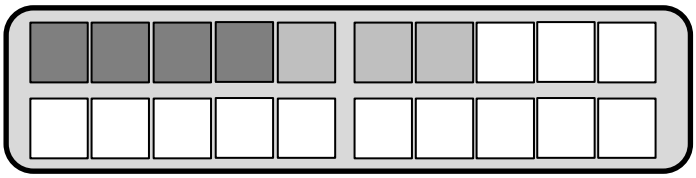

14 + 3 =___

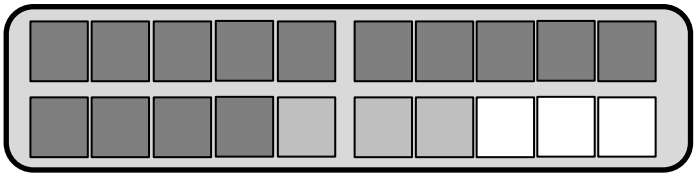

6 + 3 = ___

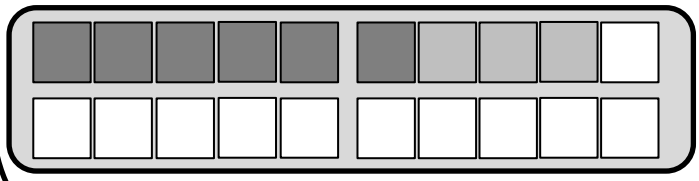

16 + 3 = ___

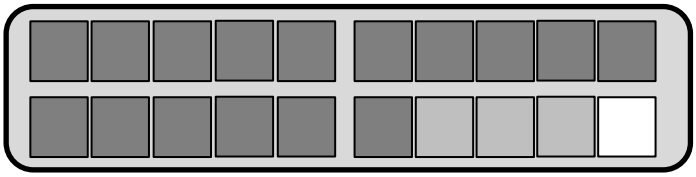

www.lernmaterial.mathematikbegreifen.de

5 + 3 = ___

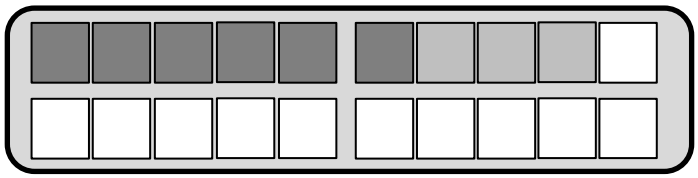

15 + 3 =___

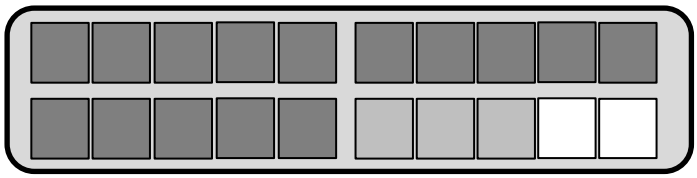

4 + 3 = ___

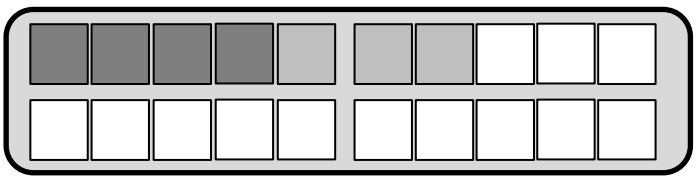

14 + 3 =___

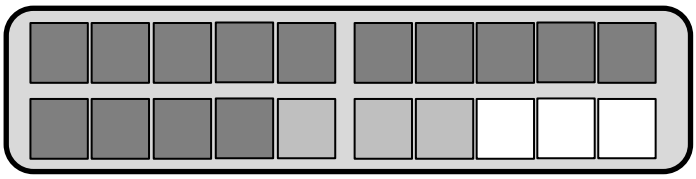

6 + 3 = ___

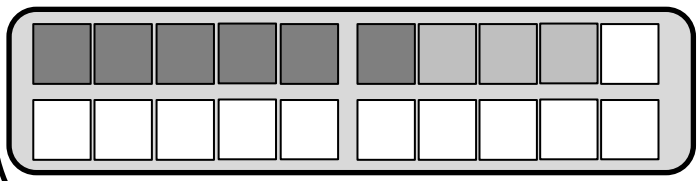

16 + 3 = ___

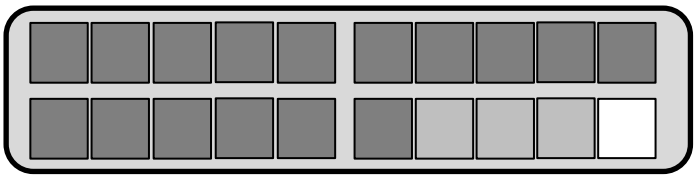

www.lernmaterial.mathematikbegreifen.de

6 + 2 = ___

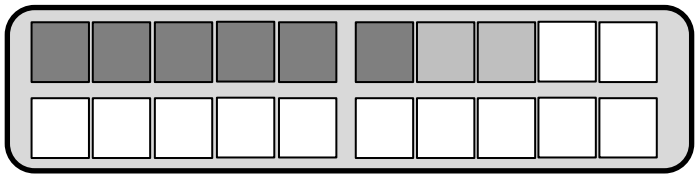

16 + 2 =___

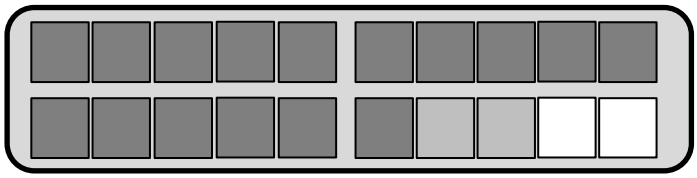

7 + 1 = ___

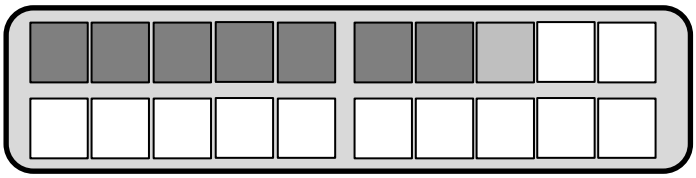

17 + 1= ___

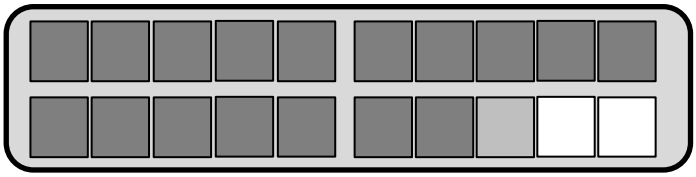

8 + 1 = ___

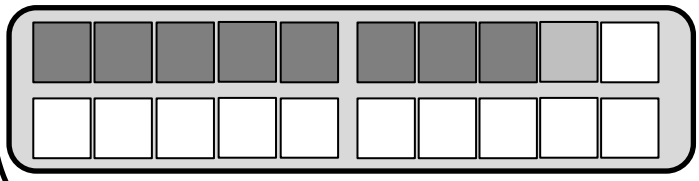

18 + 1 = ___

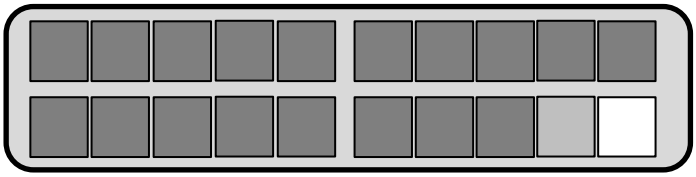

6 + 2 = ___

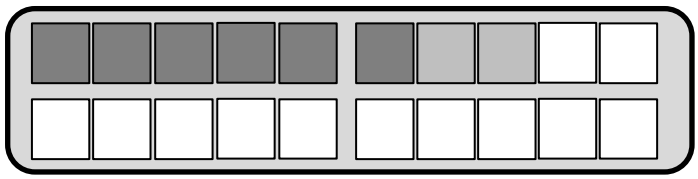

16 + 2 =___

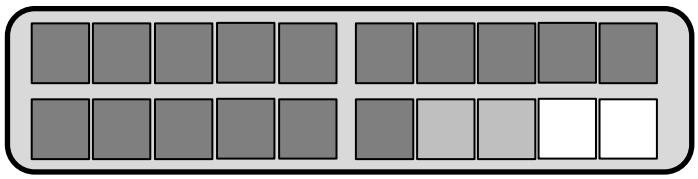

7 + 1 = ___

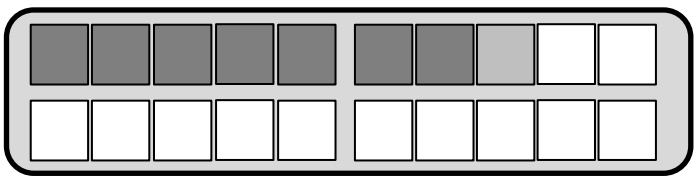

17 + 1= ___

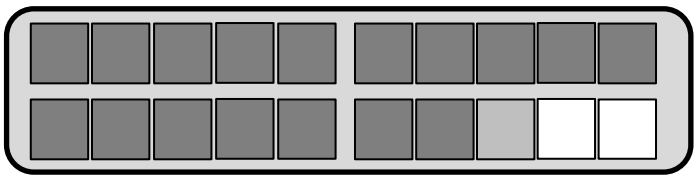

8 + 1 = ___

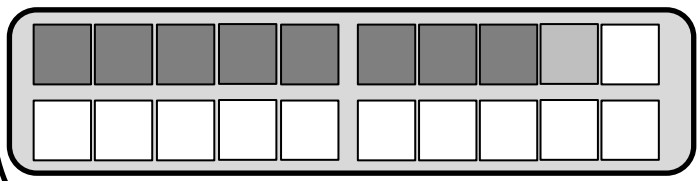

18 + 1 = ___

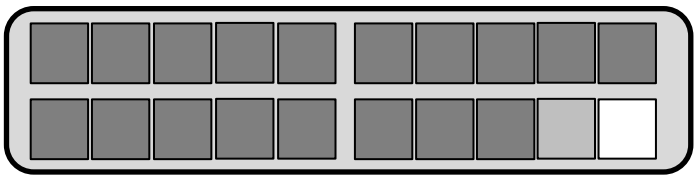

www.lernmaterial.mathematikbegreifen.de

2 + 7 = ___

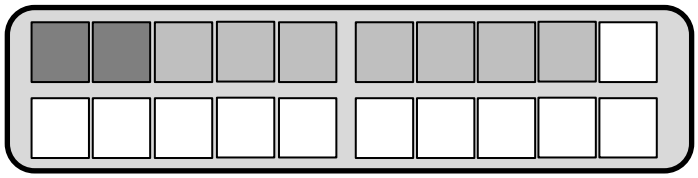

12 + 7 =___

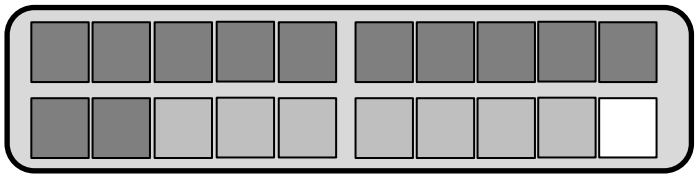

1 + 8 = ___

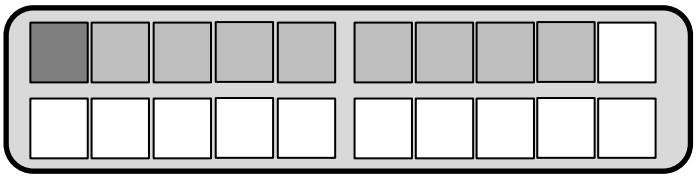

11 + 8 =___

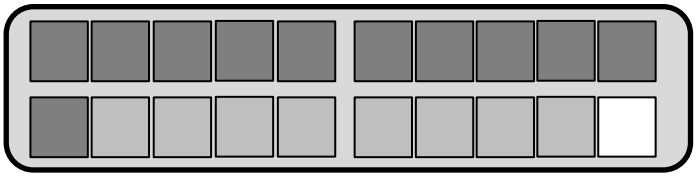

4 + 3 = ___

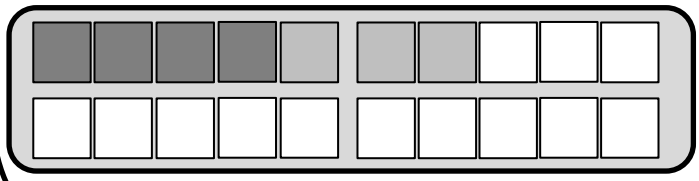

14 + 3 =___

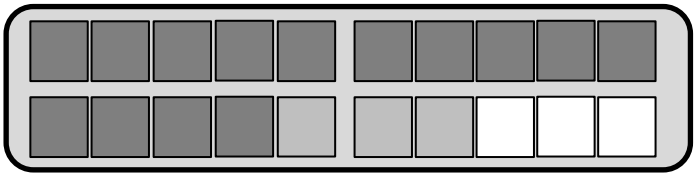

2 + 7 = ___

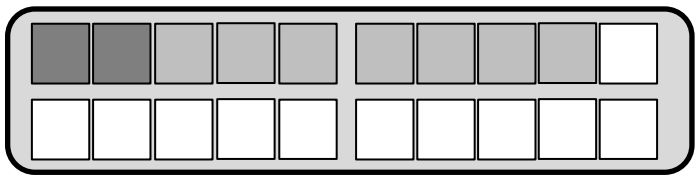

12 + 7 =___

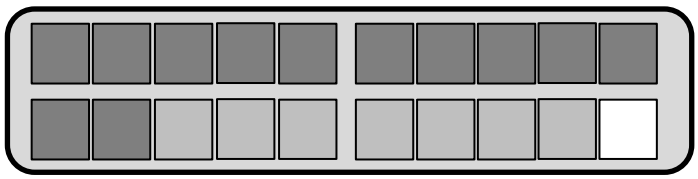

1 + 8 = ___

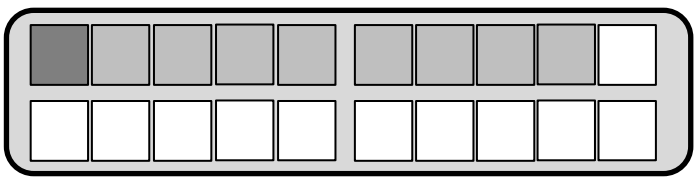

11 + 8 = ___

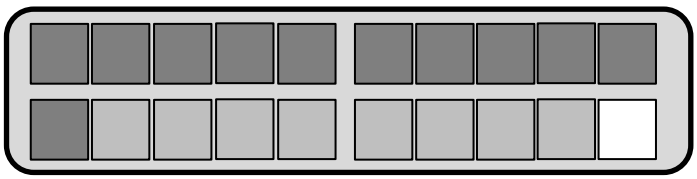

4 + 3 = ___

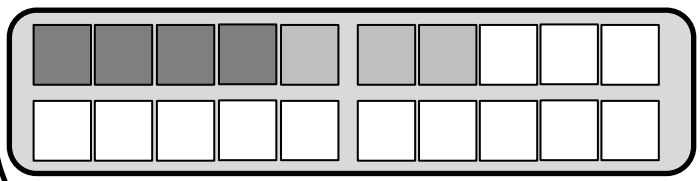

14 + 3 =___

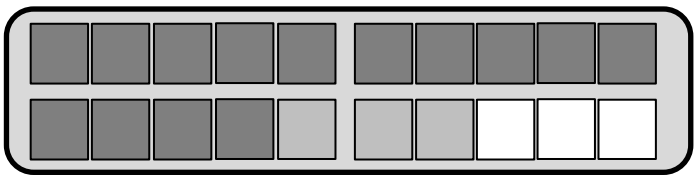

www.lernmaterial.mathematikbegreifen.de

2 + 5 = ____

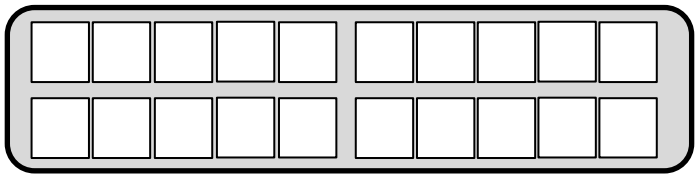

12 + 5 = ____

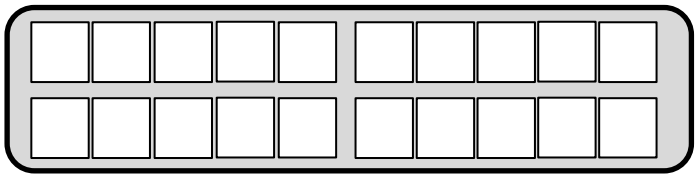

3 + 6 = ____

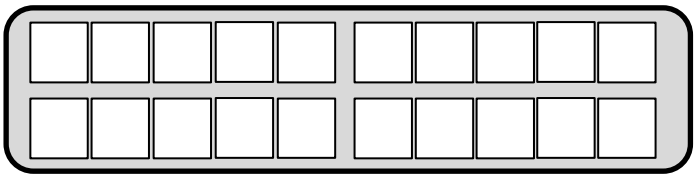

13 + 6 = ____

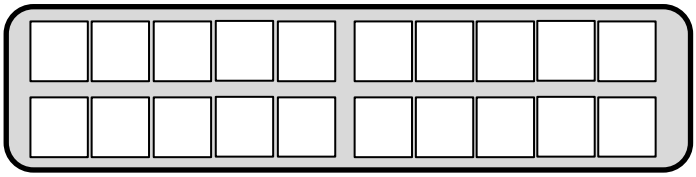

4 + 6 = ____

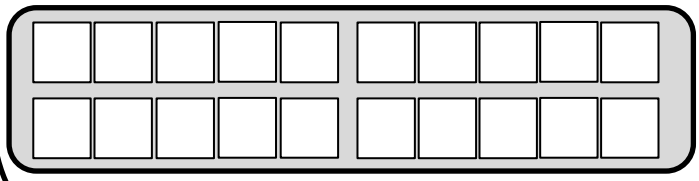

14 + 6 = ____

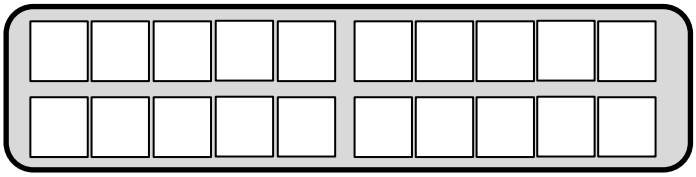

2 + 5 = ____

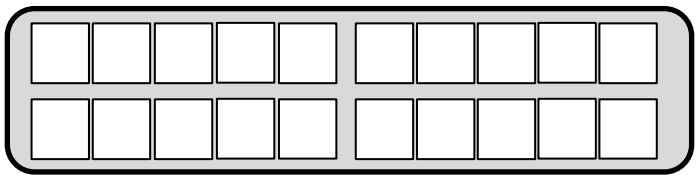

12 + 5 = ____

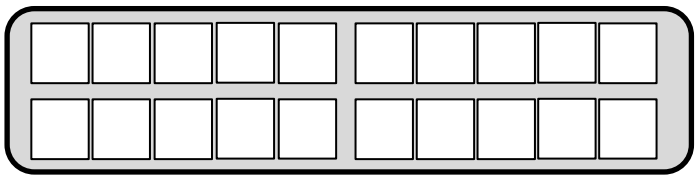

3 + 6 = ____

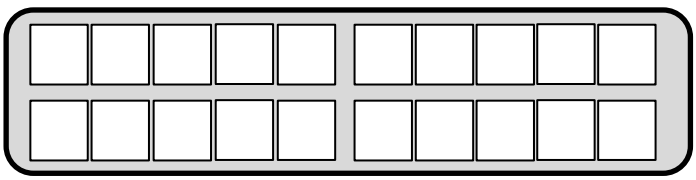

13 + 6 = ____

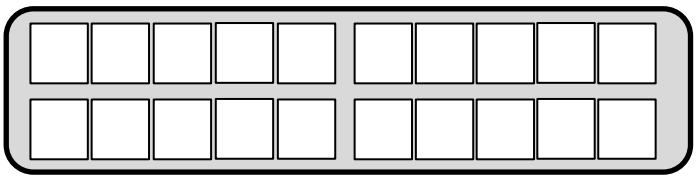

4 + 6 = ____

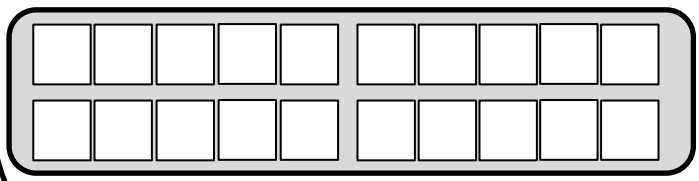

14 + 6 = ____

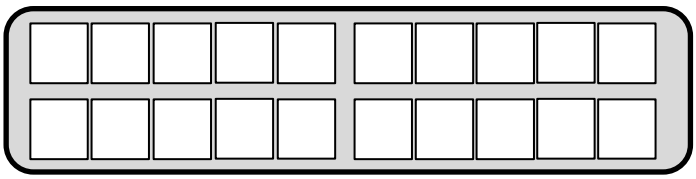

www.lernmaterial.mathematikbegreifen.de

3 + 5 = ____

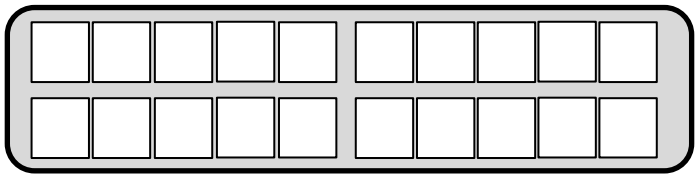

13 + 5 = ____

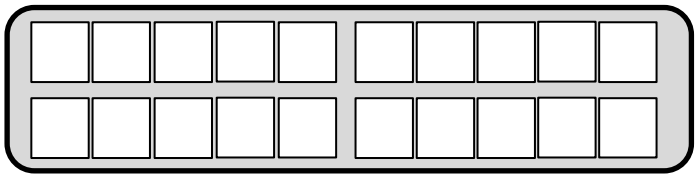

3 + 2 = ____

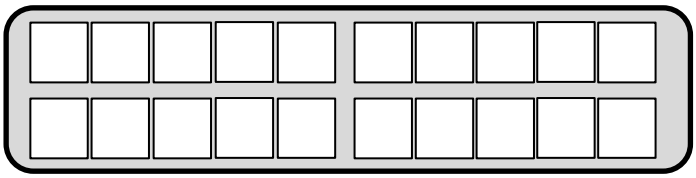

13 + 2 = ____

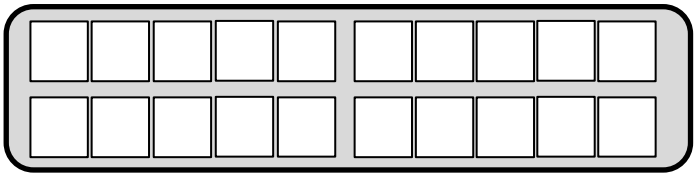

6 + 3 = ____

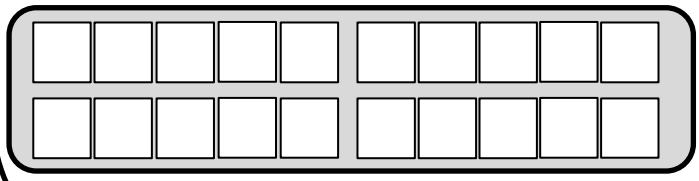

16 + 3 = ____

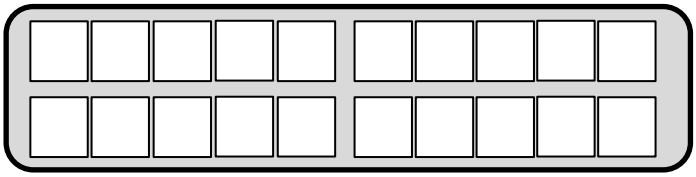

3 + 5 = ____

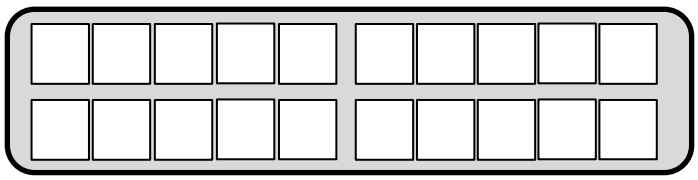

13 + 5 = ____

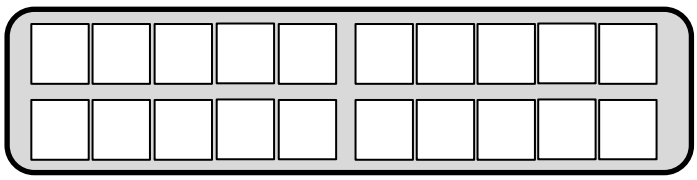

3 + 2 = ____

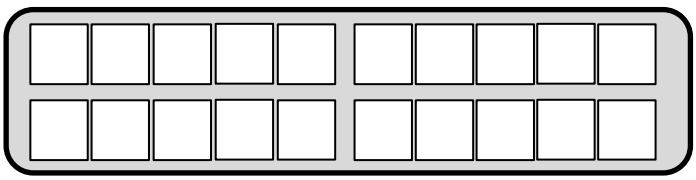

13 + 2 = ____

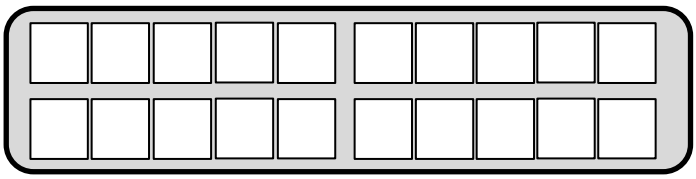

6 + 3 = ____

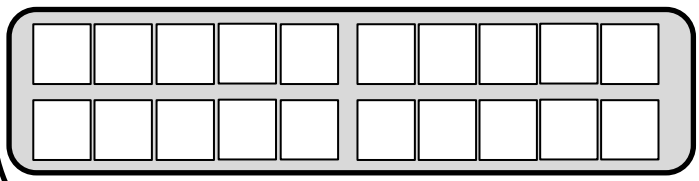

16 + 3 = ____

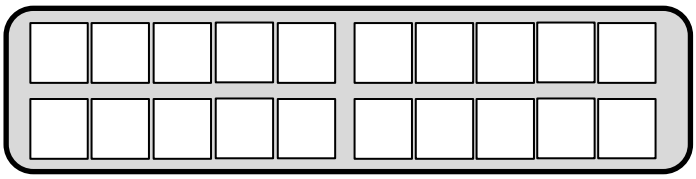

www.lernmaterial.mathematikbegreifen.de

5 + 3 = ____

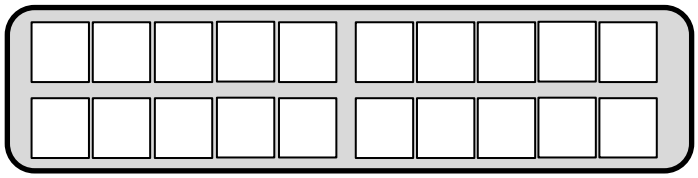

15 + 3 = ____

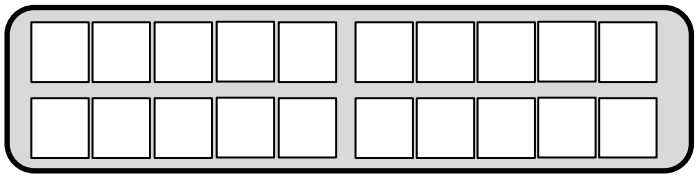

2 + 3 = ____

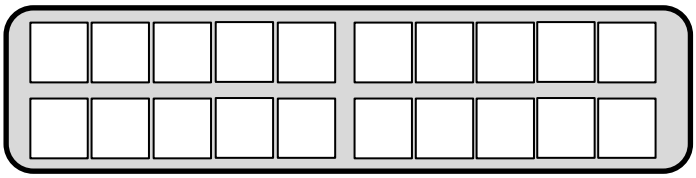

12 + 3 = ____

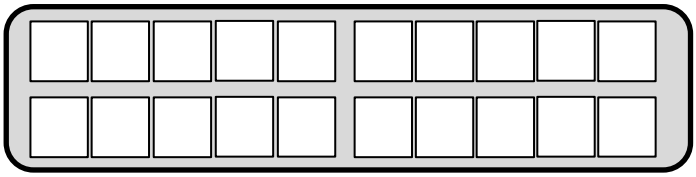

3 + 6 = ____

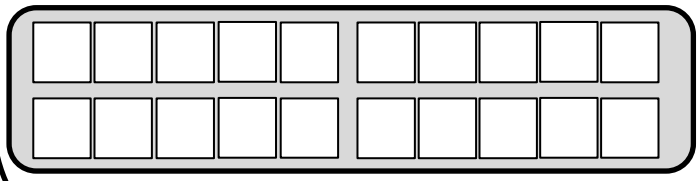

13 + 6 = ____

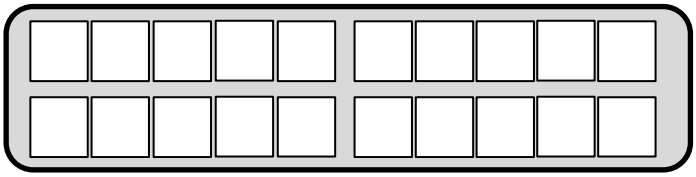

5 + 3 = ____

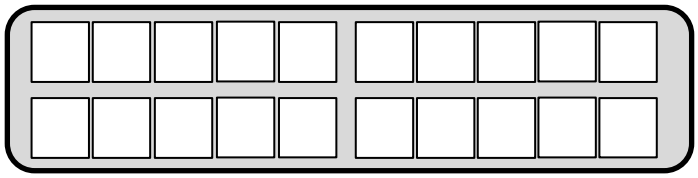

15 + 3 = ____

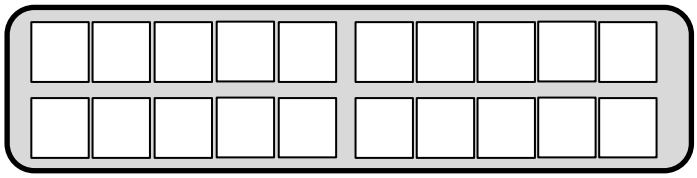

2 + 3 = ____

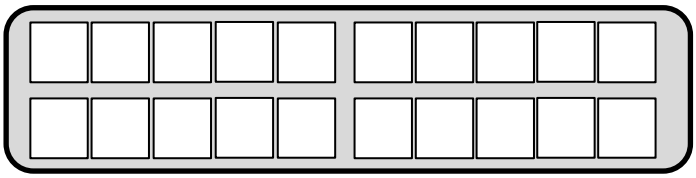

12 + 3 = ____

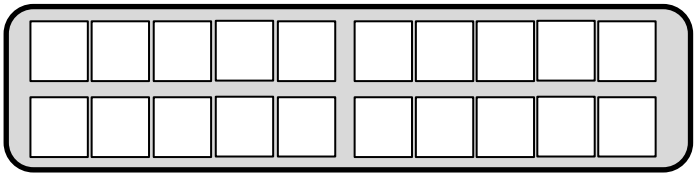

3 + 6 = ____

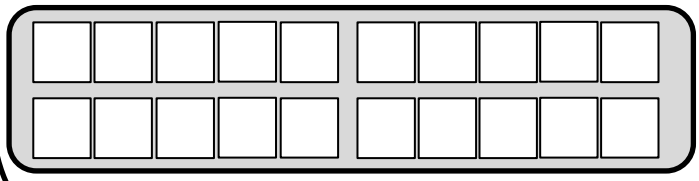

13 + 6 = ____

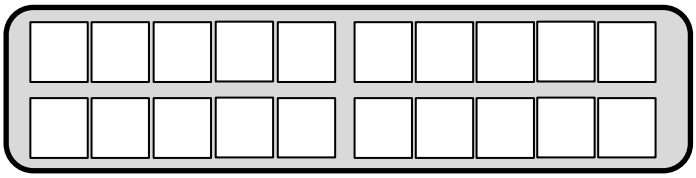

www.lernmaterial.mathematikbegreifen.de

Rechne die Hilfsaufgabe zuerst!



3 + 2 = 5

13 + 2 = 15

4 + 5 = ___

14 + 5 = ___

3 + 5 = ___

13 + 5 = ___

5 + 3 = ___

15 + 3 = ___

5 + 5 = ___

15 + 5 = ___

4 + 4 = ___

14 + 4 = ___

6 + 3 = ___

16 + 3 = ___

3 + 6 = ___

13 + 6 = ___

7 + 7 = ___

17 + 2 = ___

Rechne die Hilfsaufgabe zuerst!



3 + 2 = 5

13 + 2 = 15

4 + 5 = ___

14 + 5 = ___

3 + 5 = ___

13 + 5 = ___

5 + 3 = ___

15 + 3 = ___

5 + 5 = ___

15 + 5 = ___

4 + 4 = ___

14 + 4 = ___

6 + 3 = ___

16 + 3 = ___

3 + 6 = ___

13 + 6 = ___

7 + 7 = ___

17 + 2 = ___

Nutze die Hilfsaufgabe.
Rechne!

13 + 2 = 5



13 + 6 = ___

14 + 3 = ___

12 + 6 = ___

16 + 3 = ___

13 + 5 = ___

17 + 2 = ___

16 + 2 = ___

15 + 4 = ___

12 + 4 = ___

11 + 9 = ___

18 + 2 = ___

Nutze die Hilfsaufgabe.
Rechne!

13 + 2 = 5

13 + 6 = ___

14 + 3 = ___

12 + 6 = ___

16 + 3 = ___

13 + 5 = ___

17 + 2 = ___

16 + 2 = ___

15 + 4 = ___

12 + 4 = ___

11 + 9 = ___

18 + 2 = ___

www.lernmaterial.mathematikbegreifen.de



14 + 3 =___

13 + 5 =___

12 + 6 =___

18 + 1 =___

12 + 5 =___

17 + 2 =___

11 + 5 =___

15 + 4 =___

12 + 4 =___

11 + 9 =___

14 + 5 = ___

11 + 5 = ___


Stell dir das Zwanzigerbrett vor.
Nutze die Hilfsaufgabe. Rechne!
13 + 2 = 15

14 + 3 =___

13 + 5 =___

12 + 6 =___

18 + 1 =___

12 + 5 =___

17 + 2 =___

11 + 5 =___

15 + 4 =___

12 + 4 =___

11 + 9 =___

14 + 5 = ___

11 + 5 = ___

Stell dir das Zwanzigerfeld vor. Rechne!

13 + 2 = 5



14 + 3 =___

13 + 6 =___

12 + 6 =___

18 + 1 =___

13 + 5 =___

17 + 2 =___

13 + 5 =___

15 + 4 =___

12 + 4 =___

11 + 9 =___

18 + 2 = ___

Stell dir das Zwanzigerfeld vor. Rechne!

13 + 2 = 5



14 + 3 =___

13 + 6 =___

12 + 6 =___

18 + 1 =___

13 + 5 =___

17 + 2 =___

13 + 5 =___

15 + 4 =___

12 + 4 =___

11 + 9 =___

18 + 2 = ___